Calculating Area of Shape

1)

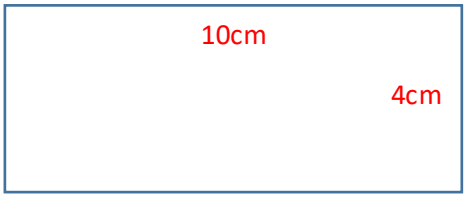

Area: _____

2)



Area: _____

3)



Area: _____

4)

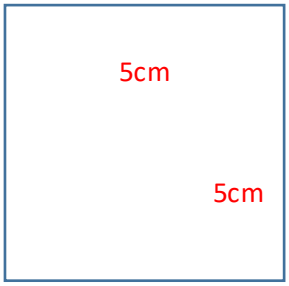

Area: _____

5)



Area: _____

6)



Area: _____

7)

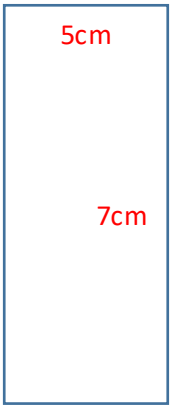

Area: _____

8)



Area: _____